Name: _____ Date: _____

Rational Numbers On Number Line - Medium

Use the number line to answer each question.

1. What number does point A represent?

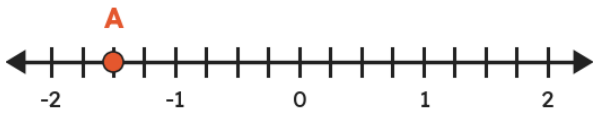

2. What number does point A represent?

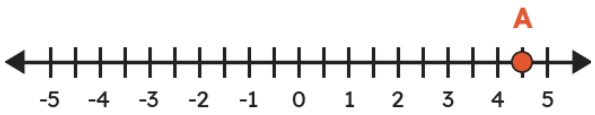

3. What number does point A represent?



4. Plot -2.5 and its opposite on the number line.

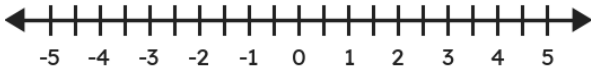

5. Plot and label 1 2/3 on the number line.

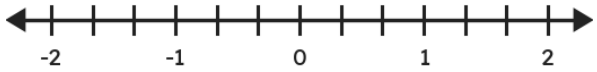

6. Plot 1 1/3 and its opposite on the number line.

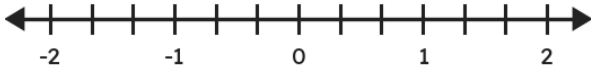

7. What number does point A represent?

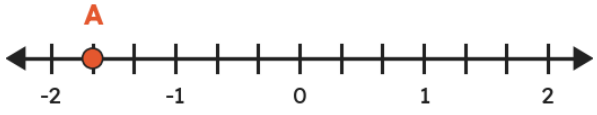

8. What number does point A represent?

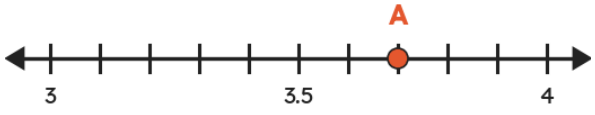

Name: _____ Date: _____

Rational Numbers On Number Line - Medium

Use the number line to answer each question.

9. What number does point A represent?

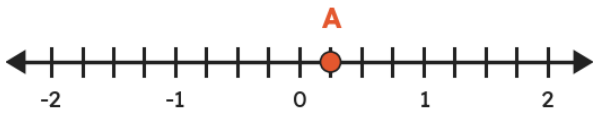

10. What number does point A represent?

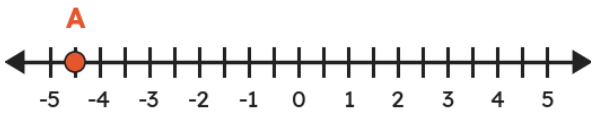

11. Plot and label -2.8 on the number line.

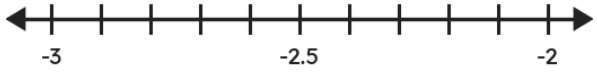

12. Plot -2/3 and its opposite on the number line.

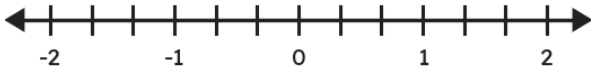

13. What number does point A represent?

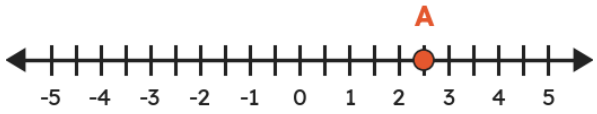

14. What number does point A represent?

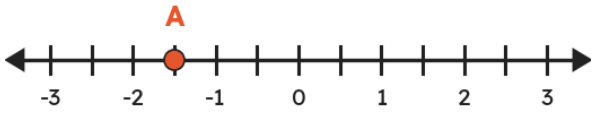

15. Plot -4.5 and its opposite on the number line.

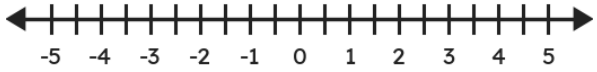

16. What number does point A represent?

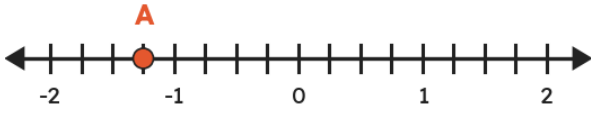

Rational Numbers On Number Line - Medium - Answer Key

1. What number does point A represent?

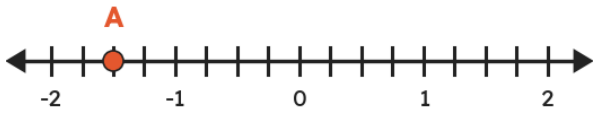

-1 1/2 (= -1.5)

2. What number does point A represent?

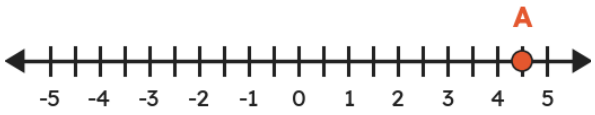

4.5

3. What number does point A represent?



0.5

4. Plot -2.5 and its opposite on the number line.

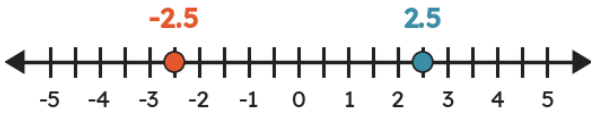

opposite: 2.5

5. Plot and label 1 2/3 on the number line.

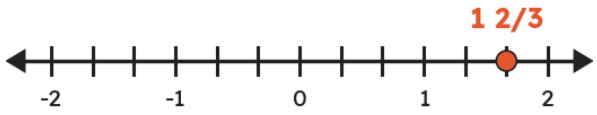

1 2/3: between 1 and 2

6. Plot 1 1/3 and its opposite on the number line.

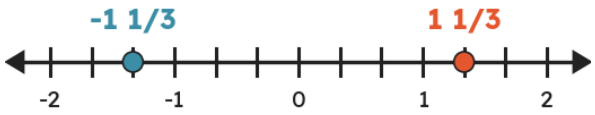

opposite: -1 1/3

7. What number does point A represent?

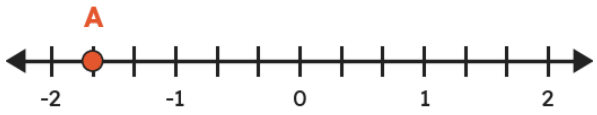

-1 2/3

8. What number does point A represent?

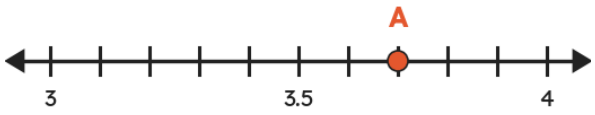

3.7

Rational Numbers On Number Line - Medium - Answer Key

9. What number does point A represent?



1/4 (= 0.25)

10. What number does point A represent?

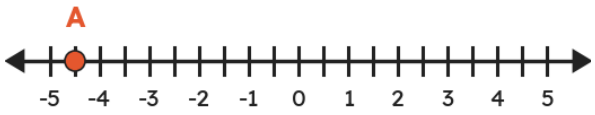

-4.5

11. Plot and label -2.8 on the number line.

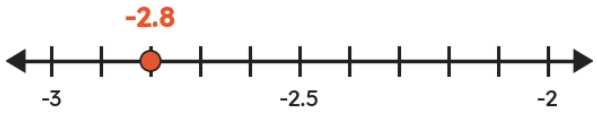

-2.8: between -3 and -2

12. Plot -2/3 and its opposite on the number line.

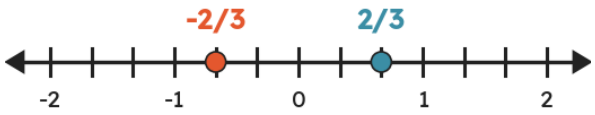

opposite: 2/3

13. What number does point A represent?

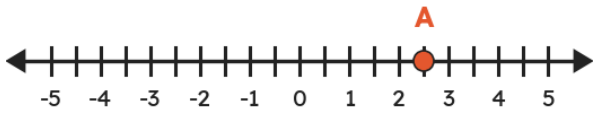

2.5

14. What number does point A represent?

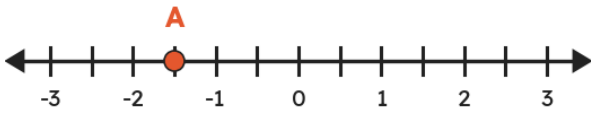

-1 1/2 (= -1.5)

15. Plot -4.5 and its opposite on the number line.

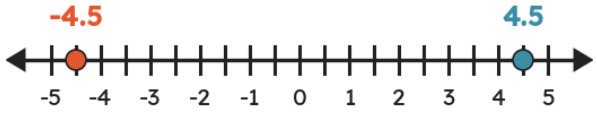

opposite: 4.5

16. What number does point A represent?

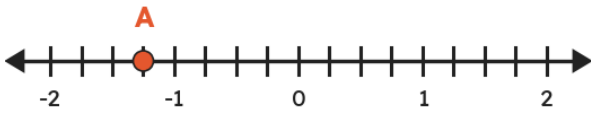

-1 1/4 (= -1.25)